Construction Material Key

Use patterns to show what each surface is made of.

Name: _____

Material key

Gravel



Boards



Brick



Soil



Fill each area using the pattern from the key.

1. Gravel path



2. Board deck



3. Brick wall

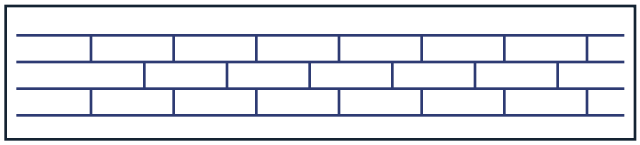

4. Soil bed

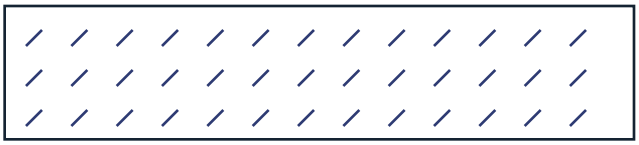

Make your own pattern for a fifth material. What would you call it?



Water (example)

Try marking all four patterns with just one pencil.